Four students watched the traffic passing their school for 1 hour.

The table shows what they saw:

Type of Vehicle	Number
Cars	60
Bicycles	30
Buses	10
Trucks	20

Each student drew a graph to show the results. Which graph shows the results correctly?

Ⓐ

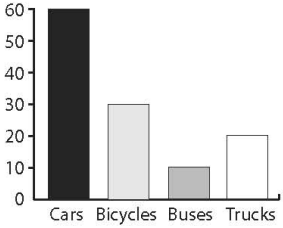

Ⓑ

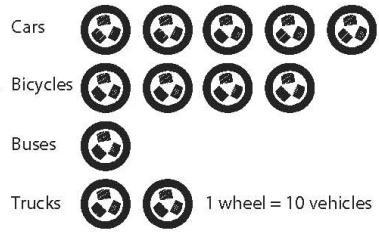

Ⓒ

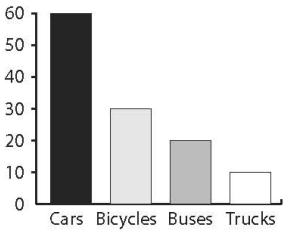

Ⓓ

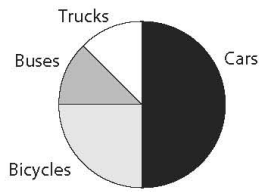

M042254

Copyright © 2008 International Association for the Evaluation of Educational Achievement (IEA). All rights reserved.

TIMSS2007

Mathematics

Eighth Grade

Four students watched the traffic passing their school for 1 hour.

The table shows what they saw:

Type of Vehicle	Number
Cars	60
Bicycles	30
Buses	10
Trucks	20

Each student drew a graph to show the results. Which graph shows the results correctly?

Ⓐ

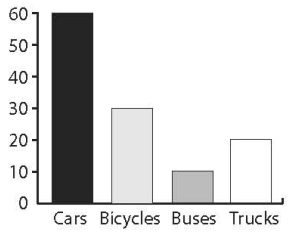

Ⓑ

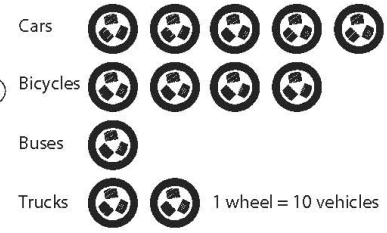

Ⓒ

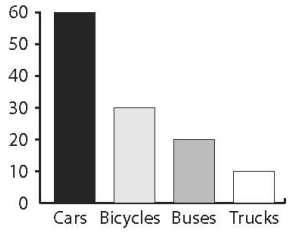

Ⓓ

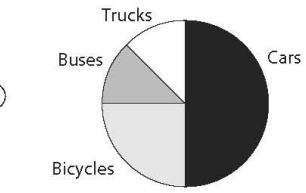

M042254

Content Domain

Data and Chance

Cognitive Domain

Applying

Maximum Points

1

Key

A

Copyright © 2008 International Association for the Evaluation of Educational Achievement (IEA). All rights reserved.

TIMSS & PIRLS International Study Center
Lynch School of Education, Boston College